Name_____

VOLUME OF A SPHERE #2

Directions: Find the volume of each sphere below. The formula to calculate the volume of a sphere is $V = \frac{4}{3}\pi r^3$, where *r* stands for the radius. Use 3.14 for π and round answers to the nearest tenth.

1)

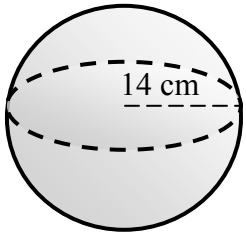

Volume = _____

2)

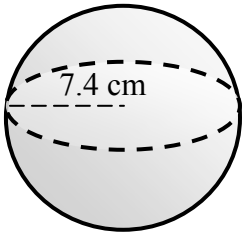

Volume = _____

3)

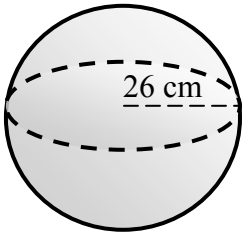

Volume = _____

4)

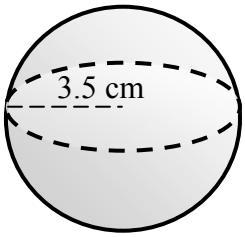

Volume = _____

5)

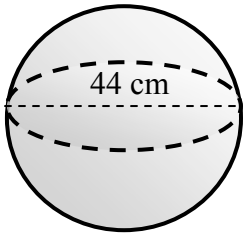

Volume = _____

6)

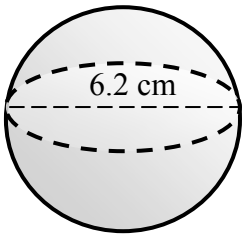

Volume = _____

7)

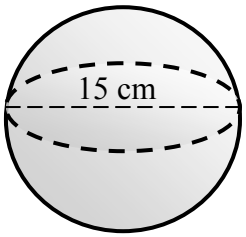

Volume = _____

8)

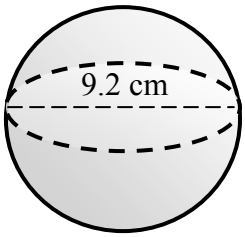

Volume = _____

9)

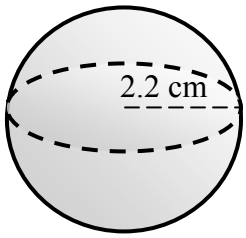

Volume = _____

10)

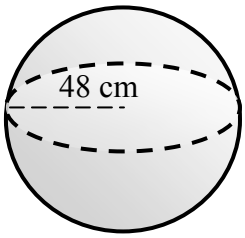

Volume = _____

11)

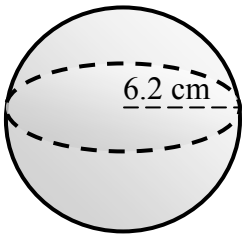

Volume = _____

12)

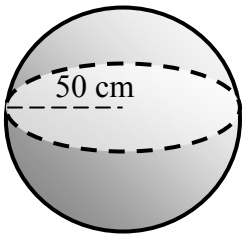

Volume = _____